Math
Geometry

Choose The Unit: Length

Which measurement would you use for each item? Choose the correct one from the word bank below and write it down to complete the sentence.

miles	inches	miles	
yards	feet	yards	

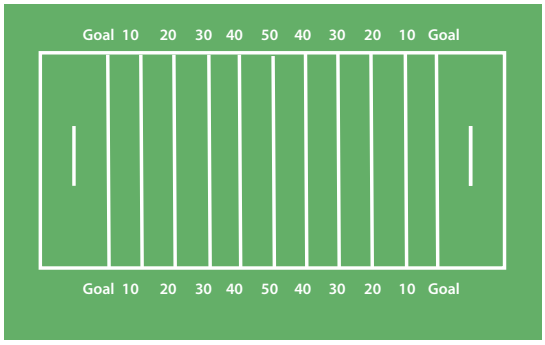

The football field measures 100 _____ long and 53 _____ wide.

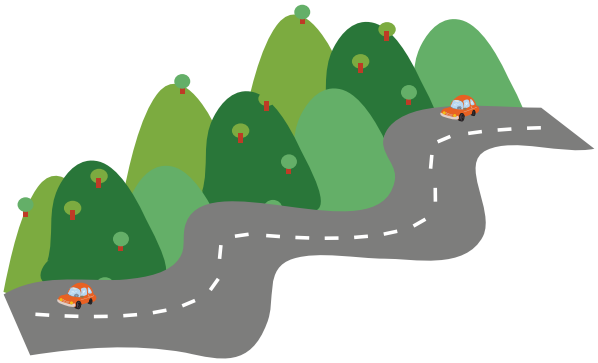

We drove 60 _____ this weekend.

This pencil is 2 _____ high.



Grandma's new chair is 21 _____ wide.

The width of California is 250 _____.

© ThuVienTiengAnh.Com